小猿口算

竖式计算-队列表演

题数: 10

___月___日　　姓名: _____

___分___秒　　班级: _____

21 × 33 	12 × 41 	20 × 22 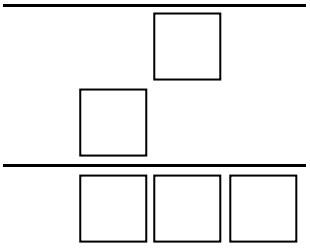	42 × 12 
20 × 42 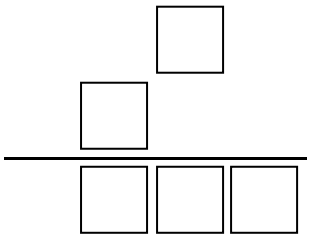	11 × 15 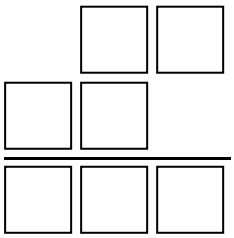	20 × 41 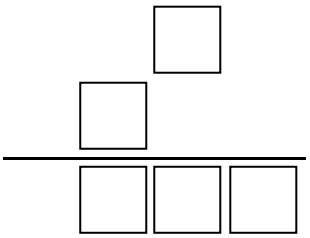	11 × 98 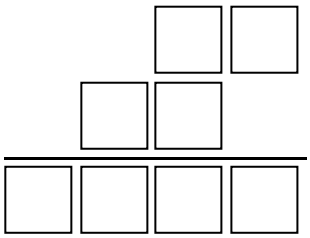
23 × 20 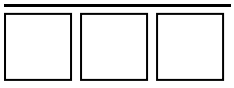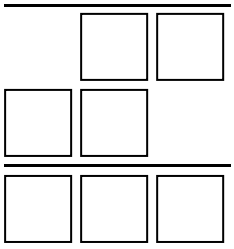	12 × 34